Estimate and Counting

Estimate and count the number of shapes and write in the boxes given below:

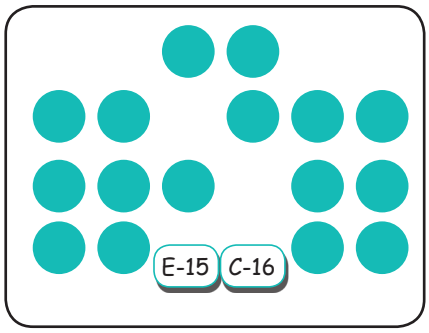

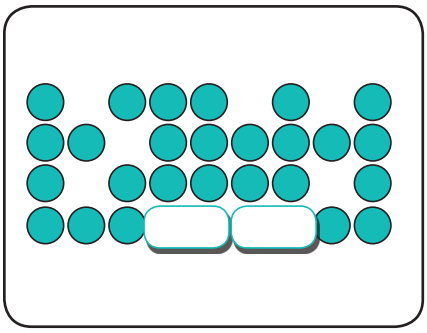

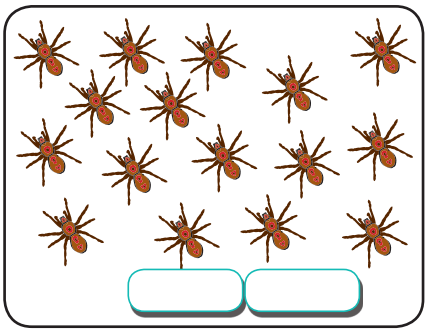



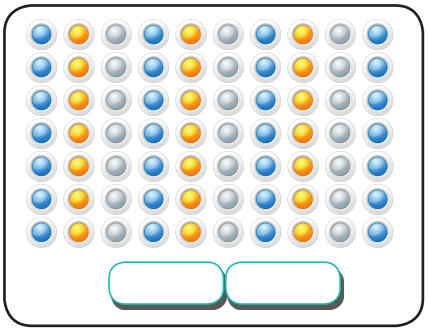

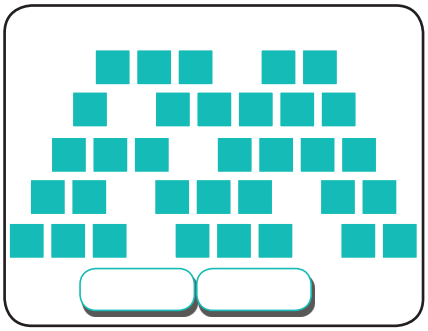

Estimate and count the number of shapes and write in the blank space:



Estimate: _____

Count: _____



Estimate: _____

Count: _____



Estimate: _____

Count: _____



Estimate: _____

Count: _____

© Copyright 2017 BeeOne Media Pvt. Ltd. All Rights Reserved.

Subscribe to access over 6,000 worksheets in
www.grade1to6.com for just USD 25/ year